Shoes to Add UP!

How many do you see? Add them together!

10 + 5 = ☐



6 + 6 = ☐

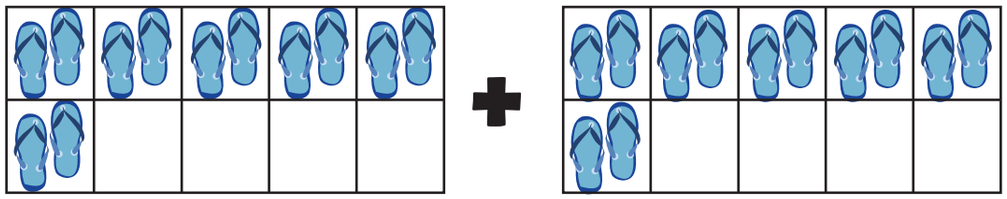

1 + 2 = ☐

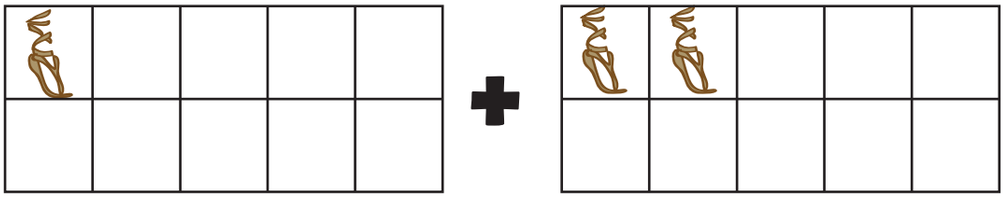

8 + 8 = ☐



9 + 9 = ☐

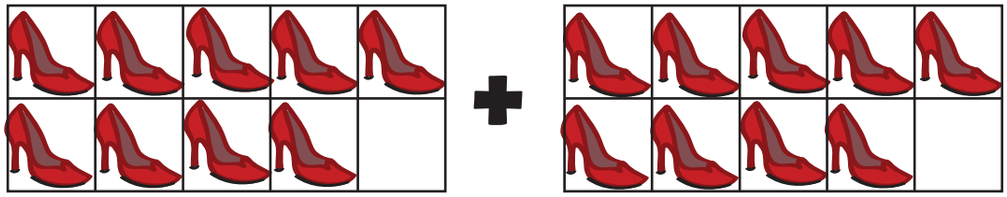

education.com Copyright © 2012-2013 by Education.com